Nombre_____

Números ordinales

	→		4º	→
6º	→	8º		

Corta las imágenes y pégalas en el lugar que corresponde.

primero	cuarto 	quinto	décimo	sexto 
tercero 	segundo	séptimo	octavo 	noveno