Nombre_____

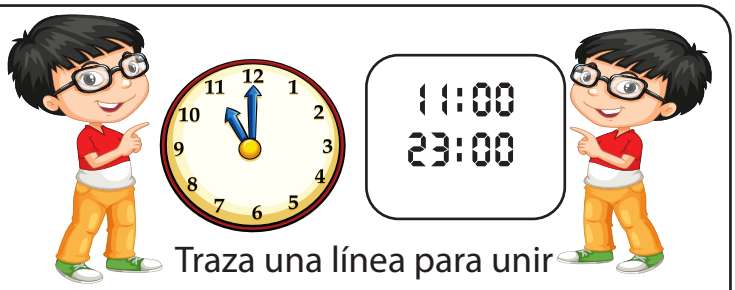

Traza una línea para unir cada reloj con la hora correcta.













1:00
13:00

3:00
15:00

6:00
18:00

00:00
12:00

5:00
17:00

2:00
14:00