Nombre_____

Mira los ejemplos y completa la información que corresponde.



Dados	Barras de conteo	Número	Nombre
	IIII	4	cuatro
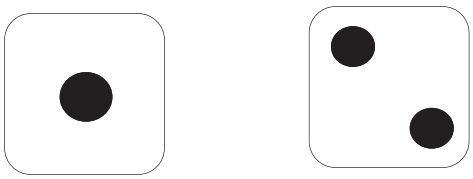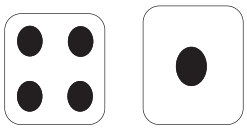	III	3	tres